ブリックブロック　Brick Block

例題　　解答

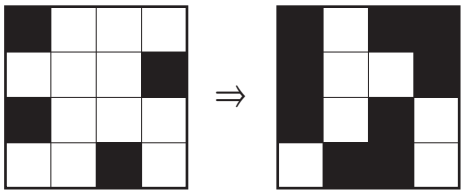

≪ルール≫

盤面のいくつかのマスを塗りつぶし、どの黒マスもタテヨコでつながったちょうど３マス分のかたまりになるようにしてください。
すべてのかたまりは角でひとつながりになるようにします。

1.



2.



3.



4.



5.