頂上プレース

例題　　解答

1～3

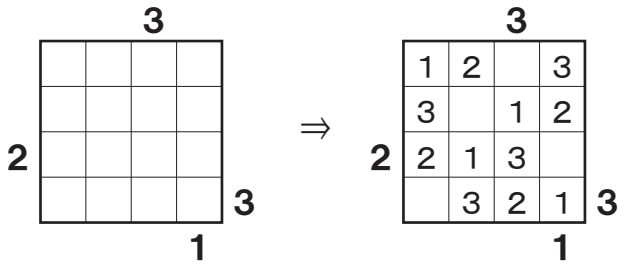

≪ルール≫

決められた範囲の数字を各列にひとつずつ入れてください。盤面の数字はそのマスの高さを表します。
周囲の数字は、そこから見て最も近い頂上（前後より高いマス）の「高さ」を表します。

1～3

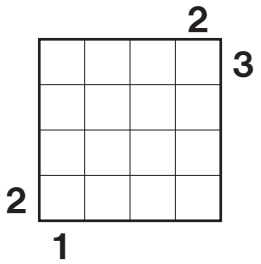

1～3

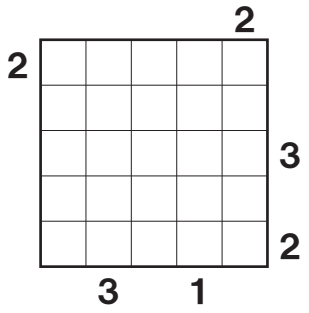

1～3

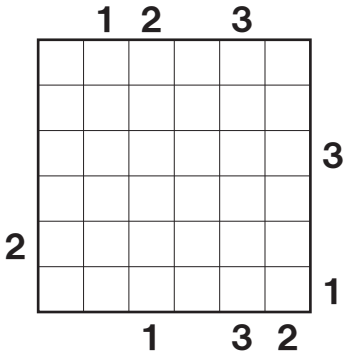

1～4

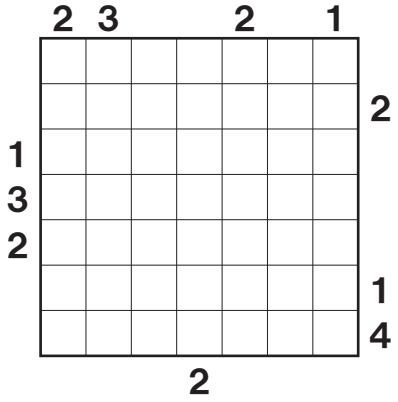
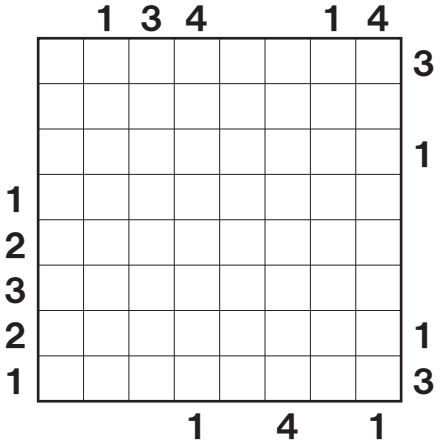
1～4