# 遠近プレース

例題　　解答

1～3

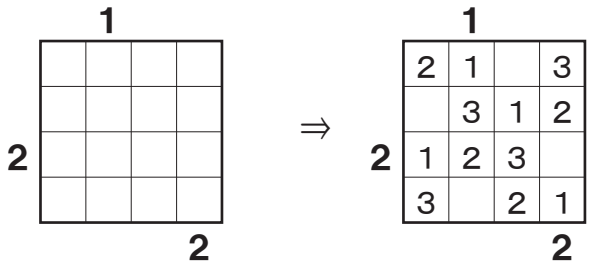


≪ルール≫

決められた範囲の数字を各列にひとつずつ入れてください。
周囲の数字は、その列で一番遠くにある数字から一番近くにある数字を引いた数をあらわします。

1～3

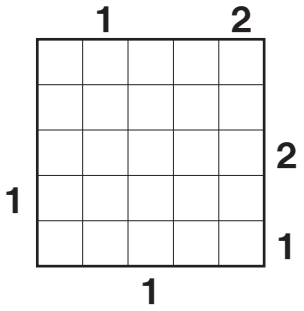


2

1～3

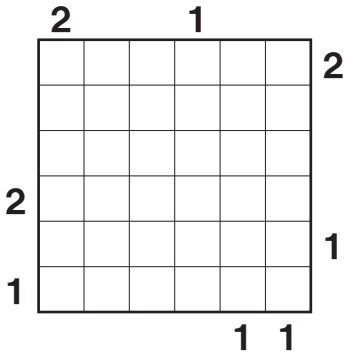


3

1～4

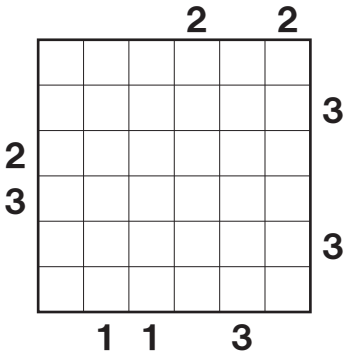


4

1～4

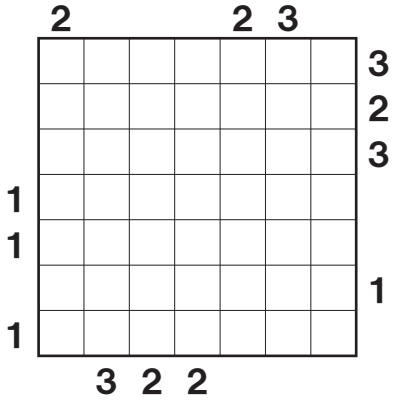


5
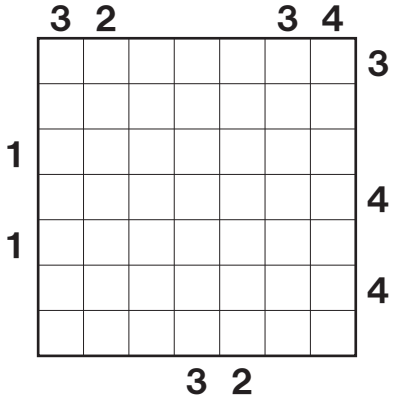
1～5